練習一

根據「集」(SET) 的定義，試從下表中，找出三幅圖像能組成為「集」(SET)。
把方格內的數字 (順序) 填在下面答案欄內。

1)

1 	2	3 
4	5	6 
7	8 	9

答案欄

方格編號: (　　) (　　) (　　)	方格編號: (　　) (　　) (　　)
方格編號: (　　) (　　) (　　)	方格編號: (　　) (　　) (　　)

2)

1 	2 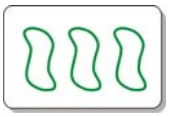	3
4 	5 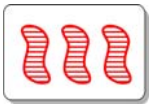	6 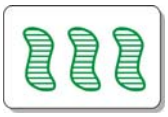
7 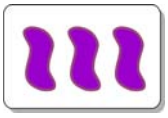	8 	9 

答案欄

方格編號: (　　) (　　) (　　)	方格編號: (　　) (　　) (　　)
方格編號: (　　) (　　) (　　)	方格編號: (　　) (　　) (　　)